Kindergarten count and compare worksheet (set 2)

Name: _____

Date: _____

Which group has fewer? (left or right — write 1 or 2)



Which group has fewer? (left or right — write 1 or 2)



Which group has fewer? (left or right — write 1 or 2)

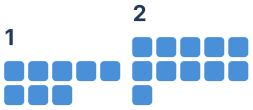

Which group has more? (left or right — write 1 or 2)



Which group has more? (left or right — write 1 or 2)



Which group has fewer? (left or right — write 1 or 2)

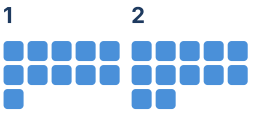

How many more in the larger group?

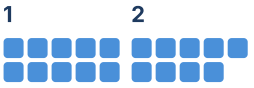

How many more in the larger group?

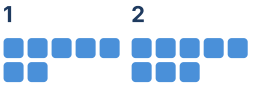

Which group has fewer? (left or right — write 1 or 2)

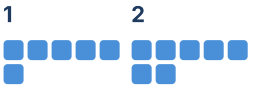

Which group has more? (left or right — write 1 or 2)

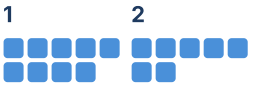

Answer key

1
2
1
1
2
1
1
1
1
1