Grade 3 number line worksheet (set 3)

Name: _____

Date: _____

Find 14 − 4 on the number line.



Start at __. Count on 2. 2 + 2 = __

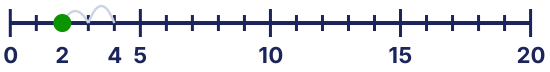

Mia has 13 beads. She gives away 9. Write an equation and use the number line.

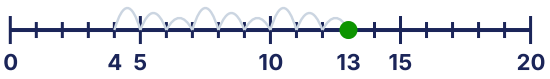

Assessment: 11 + 9 = __ (show hops on the line)



Find 12 − 9 on the number line.

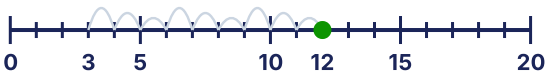

Start at __. Count on 5. 13 + 5 = __



Mia has 5 beads. She gets 6 more. Write an equation and use the number line.



Assessment: 11 − 9 = __ (show hops on the line)



Answer key

10
4
4
20
3
18
11
2