Grade 3 number line worksheet (set 2)

Name: _____

Date: _____

Find 14 − 4 on the number line.



Start at __. Count back 1. 8 − 1 = __

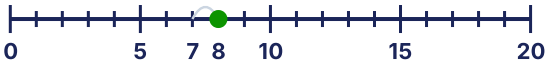

Mia has 3 beads. She gets 3 more. Write an equation and use the number line.



Assessment: 13 − 3 = __ (show hops on the line)

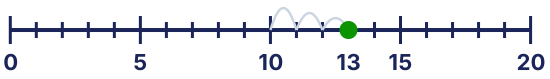

Find 4 + 6 on the number line.

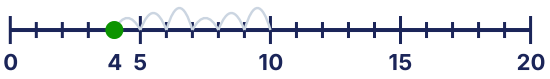

Start at __. Count on 5. 8 + 5 = __

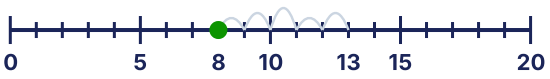

Answer key

10
7
6
10
10
13