Grade 2 place value tens and ones worksheet (set 4)

Name: _____

Date: _____

What number is shown?



What number is shown?



What number is shown?



What number is shown?



What number is shown?



What number is shown?



What number is shown?



What number is shown?



Answer key

43
11
15
21
29
22
26
50