Grade 2 place value tens and ones worksheet (set 3)

Name: _____

Date: _____

What number is shown?



What number is shown?



What number is shown?



What number is shown?



What number is shown?



What number is shown?



What number is shown?



What number is shown?



What number is shown?



What number is shown?



What number is shown?



What number is shown?



Answer key

77
50
21
10
41
88
84
48
13
87
36
37