Grade 2 place value tens and ones worksheet (set 1)

Name: _____

Date: _____

What number is shown?



What number is shown?



What number is shown?



What number is shown?



What number is shown?



What number is shown?



What number is shown?



What number is shown?



Answer key

17
55
41
35
56
59
21
12