Grade 2 number line worksheet (set 4)

Name: _____

Date: _____

Find 5 + 3 on the number line.

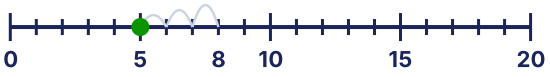

Start at __. Count back 1. 4 − 1 = __

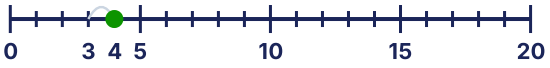

Mia has 7 beads. She gives away 1. Write an equation and use the number line.

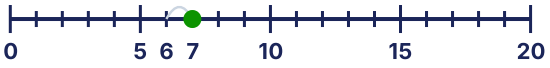

Assessment: 6 + 4 = __ (show hops on the line)



Answer key

8
3
6
10