Grade 2 number line worksheet (set 3)

Name: _____

Date: _____

Find 7 + 5 on the number line.

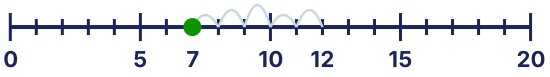

Start at __. Count on 2. 9 + 2 = __



Mia has 9 beads. She gives away 2. Write an equation and use the number line.

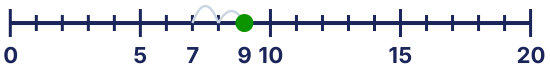

Assessment: 17 − 8 = __ (show hops on the line)

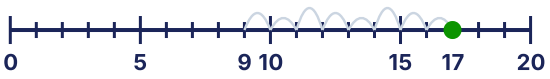

Find 8 − 4 on the number line.



Start at __. Count back 4. 14 − 4 = __

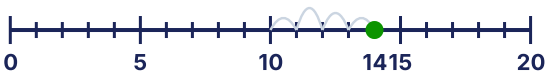

Mia has 4 beads. She gets 4 more. Write an equation and use the number line.



Assessment: 7 − 4 = __ (show hops on the line)



Answer key

12
11
7
9
4
10
8
3