# Grade 1 number line worksheet

Name: _____

Date: _____

**Find 7 + 6 on the number line.**

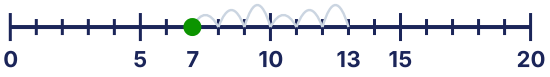

Start at __. Count on 1. 10 + 1 = __



Mia has 7 beads. She gives away 6. Write an equation and use the number line.



Assessment: 11 + 3 = __ (show hops on the line)



Find 8 + 7 on the number line.

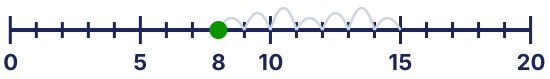

Start at __. Count back 2. 8 − 2 = __

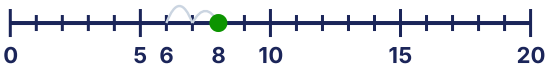

## Answer key

13
11
1
14
15
6