Grade 1 number line worksheet (set 3)

Name: _____

Date: _____

Find 15 − 6 on the number line.

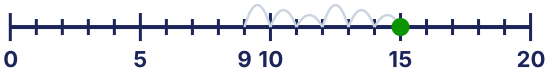

Start at __. Count on 8. 4 + 8 = __

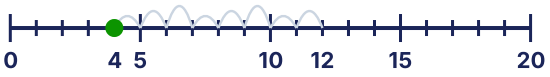

Mia has 13 beads. She gives away 2. Write an equation and use the number line.



Assessment: 7 + 6 = __ (show hops on the line)

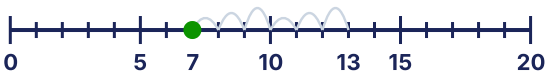

Find 12 + 8 on the number line.



Start at __. Count on 5. 10 + 5 = __



Mia has 16 beads. She gives away 2. Write an equation and use the number line.

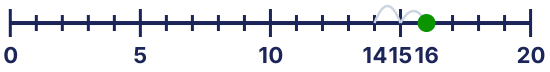

Assessment: 12 − 2 = __ (show hops on the line)



Answer key

9
12
11
13
20
15
14
10