Grade 1 counting cubes worksheet (set 2)

Name: _____

Date: _____

How many cubes?



How many cubes?



How many cubes?



How many cubes?



How many cubes?



How many cubes?



How many cubes?



How many cubes?



How many cubes?



How many cubes?



Answer key

13
5
28
26
6
11
21
3
22
4