Grade 1 count to 100 worksheet (set 4)

Name: _____

Date: _____

How many cubes? Count by tens, then ones.



How many cubes? Count by tens, then ones.



How many cubes? Count by tens, then ones.



How many cubes? Count by tens, then ones.



How many cubes? Count by tens, then ones.



How many cubes? Count by tens, then ones.



How many cubes? Count by tens, then ones.



How many cubes? Count by tens, then ones.



Answer key

15
41
45
35
24
43
11
32