Grade 1 count to 100 worksheet (set 3)

Name: _____

Date: _____

How many cubes? Count by tens, then ones.



How many cubes? Count by tens, then ones.



How many cubes? Count by tens, then ones.



How many cubes? Count by tens, then ones.



How many cubes? Count by tens, then ones.



How many cubes? Count by tens, then ones.



How many cubes? Count by tens, then ones.



How many cubes? Count by tens, then ones.



How many cubes? Count by tens, then ones.



How many cubes? Count by tens, then ones.



How many cubes? Count by tens, then ones.



How many cubes? Count by tens, then ones.



Answer key

38
80
64
34
75
39
55
97
98
88
68
74