Grade 1 count to 100 worksheet (set 2)

Name: _____

Date: _____

How many cubes? Count by tens, then ones.



How many cubes? Count by tens, then ones.



How many cubes? Count by tens, then ones.



How many cubes? Count by tens, then ones.



How many cubes? Count by tens, then ones.



How many cubes? Count by tens, then ones.



How many cubes? Count by tens, then ones.



How many cubes? Count by tens, then ones.



How many cubes? Count by tens, then ones.



How many cubes? Count by tens, then ones.



Answer key

41
22
49
61
18
33
78
53
56
24