Grade 1 count to 100 worksheet (set 1)

Name: _____

Date: _____

How many cubes? Count by tens, then ones.



How many cubes? Count by tens, then ones.



How many cubes? Count by tens, then ones.



How many cubes? Count by tens, then ones.



How many cubes? Count by tens, then ones.



How many cubes? Count by tens, then ones.



How many cubes? Count by tens, then ones.



How many cubes? Count by tens, then ones.



Answer key

22
34
32
43
40
33
35
24